Dividing with a Numberline

Name:

Use the numberline to solve each problem.

1) 12÷6=

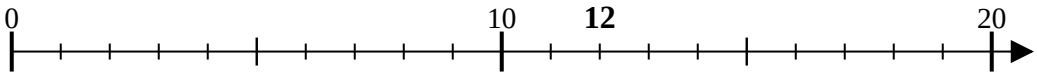

2) 50÷10=

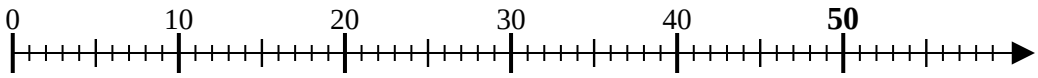

3) 6÷2=

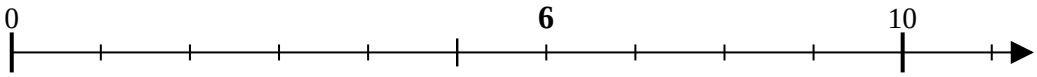

4) 36÷9=

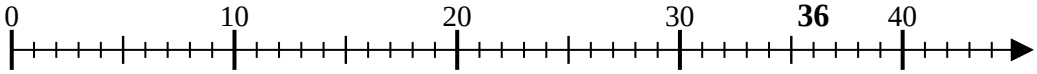

5) 16÷8=

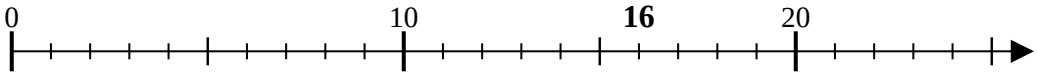

6) 8÷2=

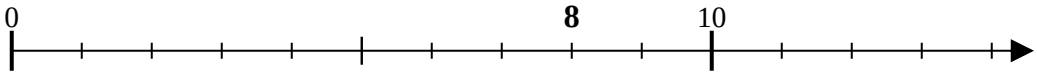

7) 35÷7=

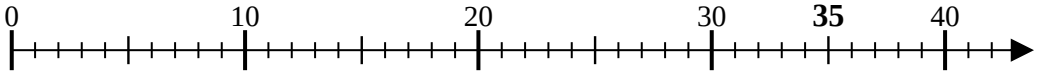

8) 40÷10=

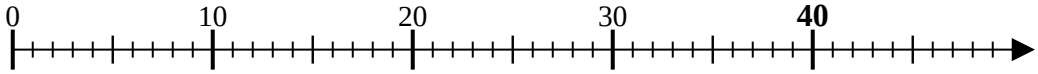

9) 18÷6=

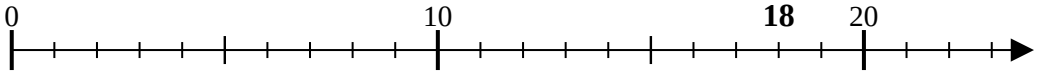

10) 10÷2=

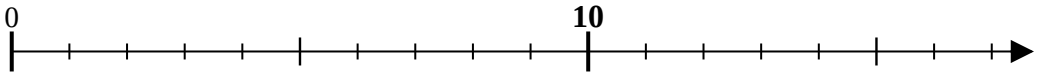

11) 30÷6=

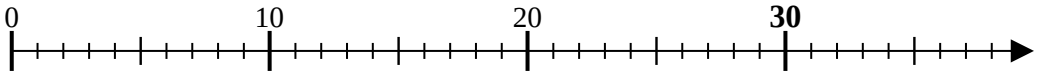

Answers

1. _____
2. _____
3. _____
4. _____
5. _____
6. _____
7. _____
8. _____
9. _____
10. _____
11. _____

1-10	91	82	73	64	55	45	36	27	18	9
11	0									

Dividing with a Numberline

Name: **Answer Key**

Use the numberline to solve each problem.

1) 12÷6=

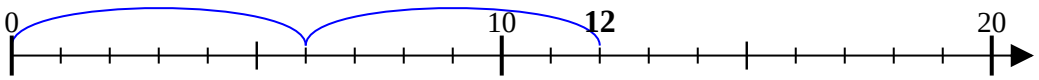

2) 50÷10=

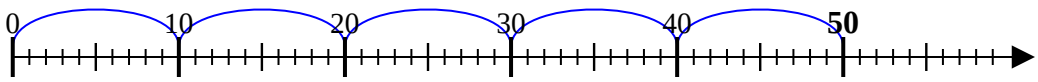

3) 6÷2=

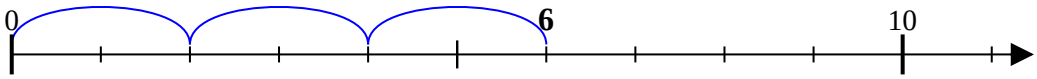

4) 36÷9=

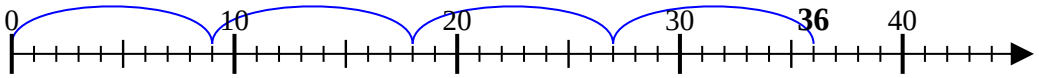

5) 16÷8=

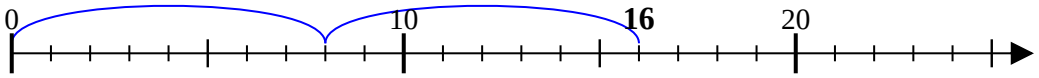

6) 8÷2=

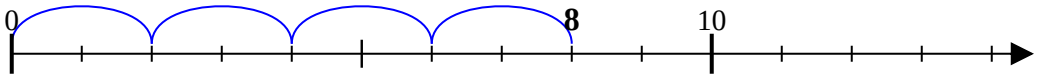

7) 35÷7=

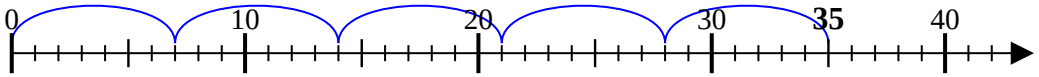

8) 40÷10=

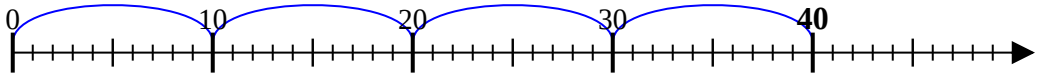

9) 18÷6=

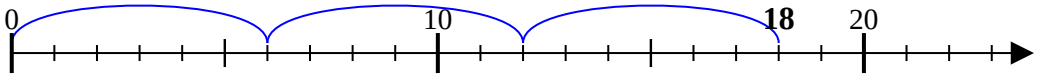

10) 10÷2=

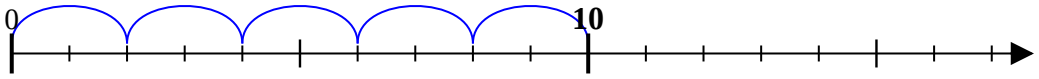

11) 30÷6=

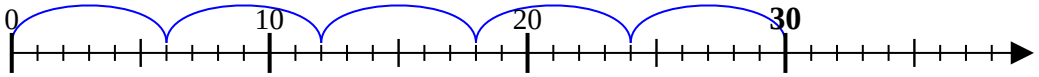

Answers

1. 2
2. 5
3. 3
4. 4
5. 2
6. 4
7. 5
8. 4
9. 3
10. 5
11. 5

1-10	91	82	73	64	55	45	36	27	18	9
11	0									